Geometry
Homework: Angles in Circles

Name: Key
Date:

Find the indicated measures.

1. m∠A = 79°

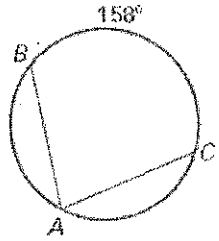

2. $m\widehat{BC}$ = 152°

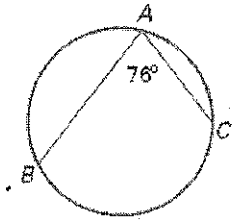

3. m∠C = 40°

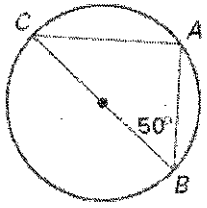

4. x = 118°
y = 118°

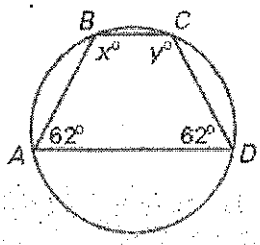

5. m∠1 = 82°
m∠2 = 98°

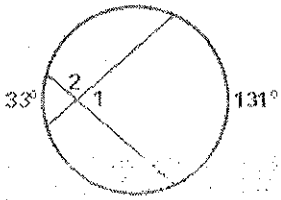

6. m∠1 = 86°

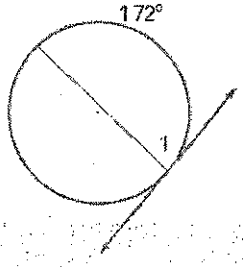

7. m∠1 = 24.5°

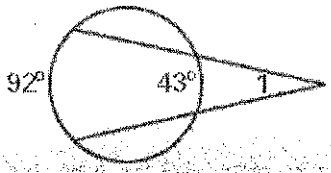

8. 1 = 90°
m∠2 = 90°

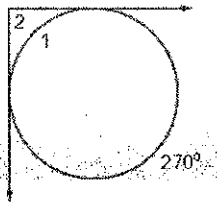

9. m∠1 = 36°

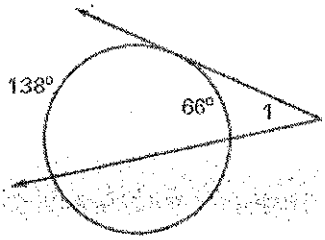

10. 1 = 55° m∠2 = 37.5°

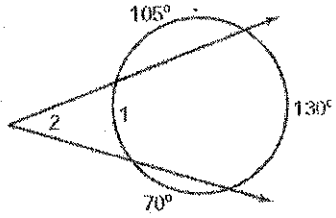
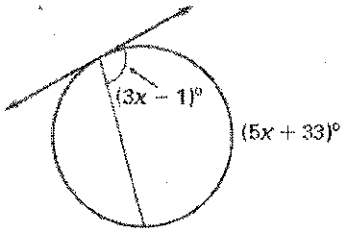
11. x = 35